All rights reserved. No part of this publication may be reproduced, distributed, or transmitted in any form or by any means, electronic, mechanical, photocopying, recording or otherwise, or stored in any retrieval system of any nature without the permission of cracku.in, application for which shall be made to support@cracku.in

Downloaded from cracku.in

SSC CHSL 15th April 2021 Shift-2

English Language

1. **Select the INCORRECTLY spelt word.**

A turtle

B tattle

C belitle

D embattle

Answer: C

2. **In the given sentence, identify the segment which contains the grammatical error.**
Economists have declared that 2020 graduates will face the worse job depression since the Great Depression because of the COVID-19 pandemic.

A Economists have declared that 2020 graduates

B will face the worse job depression

C because of the COVID-19 pandemic

D since the Great Depression

Answer: B

3. **In the given sentence, identify the segment which contains the grammatical error.**
I have made it a point to call my teachers on September 5 as a token of mine gratitude.

A on September 5 as a token

B of mine gratitude

C I have made

D it a point to call my teachers

Answer: B

4. **Examine the four jumbled sentences. Out of the given options, pick the one that gives their correct order.**
A. These young cadets undergo a rigorous training program which is aimed to prepare them for the Armed Forces.
B. Finally after the Senior Secondary examination these cadets compete to qualify for entry into the National Defence Academy located in Pune.
C. It is also referred to as the Cradle or Excellence which trains cadets from the early age of 12.
D. Nestled in a lush green campus of 18 acres in Dehradun Cantonment is the RIMC, the Rashtriya Indian Military Academy.

A DCAB

B CABD

C DABC

D ABDC

Answer: A

Downloaded from cracku.in

5. **Select the most appropriate option to fill in the blank.**
Courts are _____ of the Constitution as they are expected to see that it is always respected.

A leaders

B dictators

C sentinels

D masters

Answer: C

6. **Select the option that will improve the underlined segment in the given sentence. In case no improvement is needed, select 'No improvement'**
It is the responsibility of all of us to invest time and effort in verifying information and <u>not follow victim</u> to fake news.

A not following victim

B not fall victim

C not falls victim

D No improvement

Answer: B

7. **Select the correct indirect form of the given sentence.**
"Let's not have non-vegetarian meals in summer," Aruna said to her son.

A Aruna will suggest to her son that they should not have non-vegetarian meals in summer.

B Aruna suggested to her son that they should not have non-vegetarian meals in summer.

C Aruna has been suggesting to her son that they should not have non-vegetarian meals in summer.

D Aruna suggesting to her son that we should not have non-vegetarian meals in summer.

Answer: B

SSC CHSL Prevoius Papers (DOWNLOAD PDF)

8. **Select the most appropriate meaning of the given idiom.**
Be glad to see the back of

A Be happy at another's success

B Be relieved at another's failure

C Be happy to see someone again

D Be happy when a person leaves

Answer: D

9. **Select the option which means the same as the group of words given.**
An act of breaking or failing to observe a law

Downloaded from cracku.in

A braid

B breach

C brooch

D brusque

Answer: B

10. **Select the most appropriate ANTONYM of the given word.**
MEAGRE

A sufficient

B scares

C deficient

D scanty

Answer: A

SSC CGL Previous Papers (DOWNLOAD PDF)

11. **Select the most appropriate option to fill in the blank.**
According to Soli Sorabjee, listening to cases being argued in court can be _____ but there are lighter moments too.

A tedious

B entertaining

C lively

D fun

Answer: A

12. **Examine the four jumbled sentences. Out of the given options, pick the one that gives their correct order.**
A. Our first impression was that both seemed a bit depressed.
B. It was much later that they became our close friends and confided about their son's tragic death.
C. The Mehras were newcomers to the neighbourhood.
D. My wife and I called on them to enquire if they needed any help.

A DBAC

B ACDB

C CDAB

D BDAC

Answer: C

13. **Select the option that will improve the underlined segment in the given sentence. In case no improvement is needed, select 'No improvement'**
Sitab has learnt how to cook really well as he regularly <u>watching</u> YouTube videos.

A No improvement

Downloaded from cracku.in

B will watch

C watch

D watches

Answer: D

SSC CGL Free Mock Test (Latest Pattern)

14. **Select the correct passive form of the given sentence.**
Anant likes experimenting with different cuisines.

A Experimenting with different cuisines is liked by Anant.

B Anant had liked experimenting with different cuisines.

C Different cuisines are being experimented with by Anant.

D Different cuisines like experimenting with Anant.

Answer: A

15. **Select the most appropriate synonym of the given word.**
RAGGED

A smooth

B torn

C original

D golden

Answer: B

16. **Select the most appropriate meaning of the given idiom.**
By the skin of one's teeth

A With the help of someone

B By a very big margin

C By a very narrow margin

D Without anyone's help

Answer: C

SSC CHSL Important Questions and Answers (Download PDF)

17. **Select the most appropriate ANTONYM of the given word.**
HORRENDOUS

A watchful

B pleasant

Downloaded from cracku.in

C dreary

D frightening

Answer: B

18. **Select the option which means the same as the group of words given.**
A patient with imaginary symptoms and diseases

A melancholic

B cardiac

C hypochondriac

D alcoholic

Answer: C

19. **Select the INCORRECTLY spelt word.**

A smallish

B forbidding

C seperate

D inapplicable

Answer: C

SSC CHSL Study Material

20. **Select the most appropriate synonym of the given word.**
ADULATION

A scorn

B adoration

C apathy

D aversion

Answer: B

Instructions [21 - 25]

In the following passage, some words have been deleted. Fill in the blanks with the help of the alternatives given. Select the most appropriate option for each blank.

Comprehension:
In order to promote reading we must become role models for the young by setting (1) _____ our own smart phones to lose ourselves in a book. We too (2) _____ switch off our devices and set aside a space and time to (3) _____ old habits that once transported us to the world of (4) _____. Studies report that such deep reading leads one to become sensitive and (5) _____ citizens of the community.

21. **Select the most appropriate option for blank no. 1.**

A about

B aside

Downloaded from cracku.in

C out

D apart

Answer: B

22. **Select the most appropriate option for blank no. 2.**

A Shall

B Should

C ought

D might

Answer: B

SSC CHSL Free App

23. **Select the most appropriate option for blank no. 3.**

A reconstruct

B react

C reignite

D redo

Answer: C

24. **Select the most appropriate option for blank no. 4.**

A imagination

B imaginative

C imagine

D imagines

Answer: A

25. **Select the most appropriate option for blank no. 5.**

A thoughtfully

B thoughtfulness

C thoughtful

D thoughtless

Answer: C

Daily Free SSC Practice Set

Downloaded from cracku.in

26. **Two different positions of the same dice are shown. Select the number that will be at the top if '1' is at the bottom.**

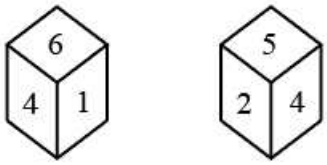

A 6

B 4

C 5

D 2

Answer: C

Free SSC Study Material (18,000 Solved Questions)

27. **Select the option that is related to the third letter-cluster in the same way as the second letter-cluster is related to the first letter-cluster.**
PRMV : KMHQ : : SQVM : ?

A NLPG

B VXSB

C NLQH

D OMRJ

Answer: C

28. **Select the correct mirror image of the given figure when the mirror is placed at the right side of the figure.**

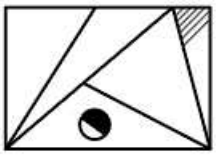

A

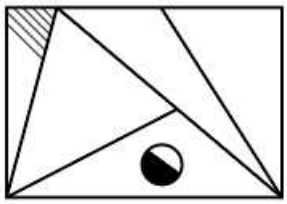

B

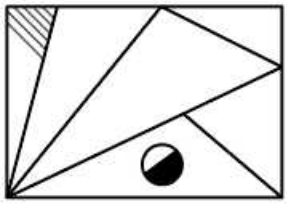

Downloaded from cracku.in

C 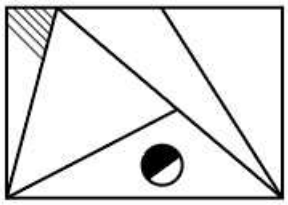

D 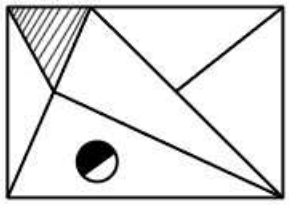

Answer: C

29. **Select the option in which the numbers are related in the same way as are the numbers of the following set.**
{9, 21, 16}

A {36, 42, 64}

B {16, 32, 25}

C {4, 20, 18}

D {8, 60, 12}

Answer: A

1500+ Very Important Free SSC Solved Questions

30. **In a certain code language, PLEASANT is written as BFMQUOBT. How will DISTANCE be written in that language?**

A TJEBUFDO

B UTJEFDOB

C UTESBFOD

D UTJEBODF

Answer: B

31. **Four letter-clusters have been given, out of which three are alike in some manner and one is different. Select the letter-cluster that is different.**

A GJDB

B MPJH

C DGBZ

D YBVT

Answer: C

32. **B and D are cousin brothers. A is the father of B and the uncle of C, who is the sister of D. C's mother is married to E, who is the brother of A. How is B related to C's father?**

A Nephew

Downloaded from cracku.in

B Uncle

C Brother-in-law

D Son

Answer: A

SSC Exam Update Videos & Free Study Material (YouTube Channel)

33. **Which two signs should be interchanged to make the following equation correct?**
$18 - 12 \div 4 + 8 \times 2 = 5$

A $+$ and $-$

B $\div$ and $\times$

C $-$ and $\div$

D $+$ and $\div$

Answer: A

34. **How many triangles are there in the following figure?**

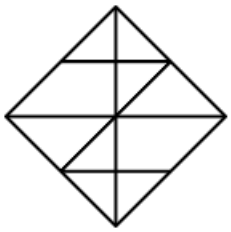

A 16

B 20

C 18

D 22

Answer: B

35. **Select the combination of letters that when sequentially placed in the gaps of the given letter series will complete the series**
g_ ctd_ wpmz_pctdawp_zgpct_a_pmz

A pgdamw

B pagmdw

C pamgwd

D pgadmw

Answer: B

Latest Job Updates on Telegram - Join here

Downloaded from cracku.in

36. **Select the option in which the numbers are related in the same way as are the numbers of the following set.**
{8, 24, 6}

A {8, 16, 3}

B {9, 40, 8}

C {14, 44, 8}

D {3, 12, 8}

Answer: D

37. **Select the option in which the given figure is embedded (rotation is NOT allowed).**

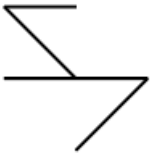

A 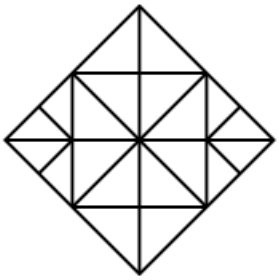

B 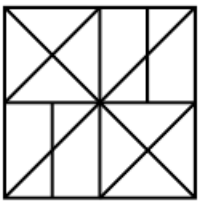

C 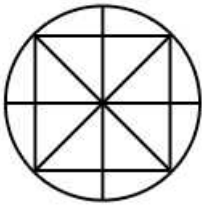

D 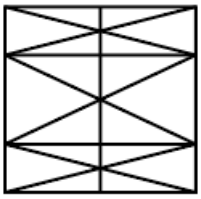

Answer: B

38. **In a certain code language, PRICK is coded as 30 and MAKE is coded as 12. How will CRAZY be coded in that language?**

A 24

B 30

C 28

D 35

Downloaded from cracku.in

Answer: C

Join SSC Daily Quiz Telegram Group

39. **Select the figure that will come next in the following series.**

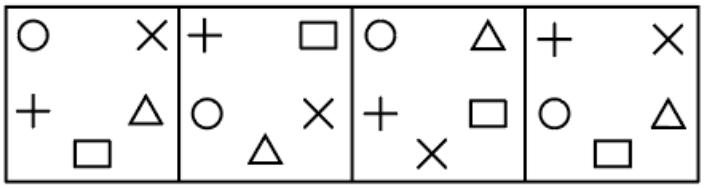

A 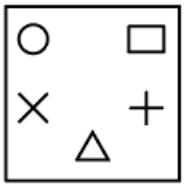

B 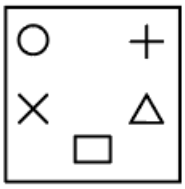

C

D 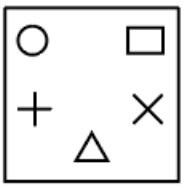

Answer: D

40. **Select the number from among the given options that can replace the question mark (?) in the following series.**
1, 6, 25, 76, ?, 154

A 134

B 123

C 153

D 164

Answer: C

41. **Four letter-clusters have been given, out of which three are alike in some manner and one is different. Select the letter-cluster that is different.**

A LHFB

B RVYC

Downloaded from cracku.in

C JFCY

D MQTX

Answer: C

42. **In the given diagram, the shapes indicate the categories of persons. The numbers given in the different segments represent the number of persons in that category.**
How many dancers are either gymnasts or singers but NOT both?

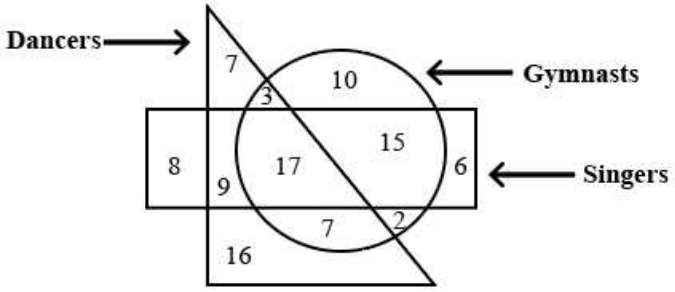

A 15

B 22

C 19

D 11

Answer: C

43. **The price of fuel has now increased by 20%. If a customer wants to keep his expenditure on fuel the same, he should reduce the consumption of the quantity of fuel by:**

A 15%

B $12\frac{1}{2}\%$

C $16\frac{2}{3}\%$

D 20%

Answer: C

44. **Four numbers have been given, out of which three are alike in some manner and one is different. Select the number that is different.**

A 344

B 126

C 1332

D 518

Answer: D

Downloaded from cracku.in

45. **Select the correct option that indicates the arrangement of the given words in a logical and meaningful order.**

1. Cook
2. Morning
3. Lunch
4. Fish
5. Market
6. Dish

A 4, 1, 6, 3, 2, 5

B 5, 2, 4, 1, 6, 3

C 4, 5, 2, 6, 3, 1

D 2, 5, 4, 1, 6, 3

Answer: D

46. **The sequence of folding a piece of circular paper and the manner in which the folded paper has been cut is shown in the following figures. How would this paper look when unfolded?**

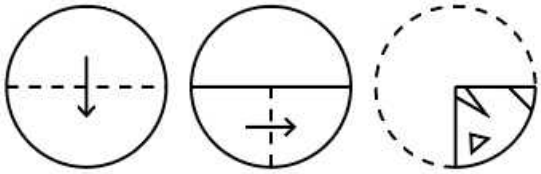

A



B



C



Downloaded from cracku.in

D 

Answer: C

47. **'Accident' is related to 'Carelessness' in the same way as 'Success' is related to '_____'.**

A Employment

B Diligence

C Promotion

D Progress

Answer: B

SSC CHSL Prevoius Papers (DOWNLOAD PDF)

48. **Select the option in which the numbers share the same relationship as that shared by the given pair of numbers.**
10 : 17

A 17 : 28

B 35 : 50

C 26 : 37

D 20 : 32

Answer: C

49. **Read the given statements and conclusions carefully. Assuming that the information given in the statements is true, even if it appears to be at variance with commonly known facts, decide which of the given conclusions logically follow(s) from the statements.**
Statements:
All jasmines are flowers.
No flower is a plant.
Some plants are herbs.
Conclusions:
I. Some jasmines are herbs.
II. No flower is a herb.
III. No jasmine is a flower.

A Only conclusions II and III follow

B Either conclusion I or II follows

C Only conclusions I and II follow.

D Only conclusion I follows.

Answer: B

Downloaded from cracku.in

50. **Select the option in which the words share the same relationship as that shared by the given pair of words.**
Anger : Emotion

A Alertness : Courage

B Rabbit : Mammal

C Grass : Lawn

D Table : Wood

Answer: B

SSC CGL Previous Papers (DOWNLOAD PDF)

Quantitative Aptitude

Instructions [51 - 52]

Study the line graph and answer the question that follows.
The line graph represents the number of vehicles (in thousands) manufactured by two automobile companies A and B over the years from 2010 to 2015. The X-axis represents the years and the Y-axis represents number ofvehicles in thousands.
(The data shown here is only for mathematical exercise. They do not represent the actual figures of the country.)

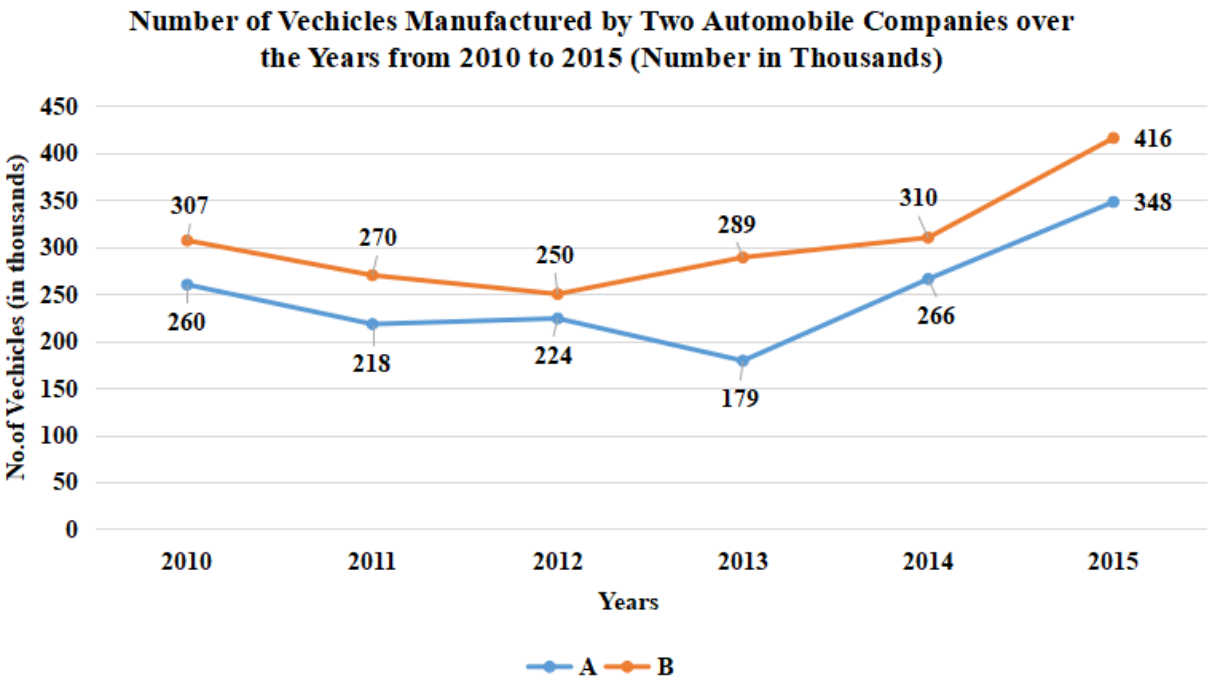

51. **If there was an increase of 24%in the average number of vehicles (in thousands) manufactured by Company B during 2011 to 2014 with respect to number of vehicles manufactured by Company A in 2009. then how many vehicles (in thousands) did Company A manufacture in 2009?**

A 257.6

B 274.6

C 247.6

D 225.6

Answer: D

Downloaded from cracku.in

SSC CGL Free Mock Test (Latest Pattern)

52. **What is the difference between the average number ofvehicles (in thousands) of the companies A and B for the years 2010. 2012. 2014 and 2015?**

A 48.25

B 45.75

C 50.25

D 46.25

Answer: D

53. **If** $(7x+3)^3+(x-2)^3+27(2x-5)^3=9(7x+3)(x-2)(2x-5)$**, then the value of** $5x+3$**is:**

A 8

B 6

C 10

D 2

Answer: A

54. **Two persons P and Q are 844 m apart. They both start cycling simultaneously in the same direction with speeds of 12 m/s and 8 ms, respectively. In how much time will P overtake Q?**

A 3 minutes and 20 seconds

B 3 minutes and 31 seconds

C 3 minutes and 18 seconds

D 3 minutes and 24 seconds

Answer: B

SSC CHSL Important Questions and Answers (Download PDF)

55. **What is the length (in cm) of the longest rod that can be fitted in a box of dimensions 28 cm** $\times$ **4 cm** $\times$ **10 cm?**

A 42

B 36

C 30

D 25

Answer: C

56. **The perimeter of an isosceles triangle is 3.6 m and its base is 30 cm shorter than each of the equal sides. What is the area (in m** ^{2}**) of the triangle?**

A 0.6

Downloaded from cracku.in

B 0.72

C 0.54

D 0.8

Answer: A

57. **What is the value of** $\frac{\tan^2 60^\circ - 2\sin^2 45^\circ}{\cos 24^\circ \cos 37^\circ \operatorname{cosec} 53^\circ \cos 60^\circ \operatorname{cosec} 66^\circ + \sin^2 60^\circ}$

A $1\frac{4}{5}$

B 1

C 2

D $1\frac{3}{5}$

Answer: D

SSC CHSL Study Material

58. **Two successive discounts of 40% and 20%, respectively, on the marked price of an article are equalto a single discount of ₹988. The marked price (in ₹) ofthe article is:**

A 2,070

B 1,900

C 2,470

D 2,200

Answer: B

59. **If the simple interest for 9 years be equal to 45% of the principal, then the rate of interest per annum is equal to:**

A 5%

B 8%

C 9%

D 6%

Answer: A

60. **By selling an article for ₹8,670, a man loses 15%. At whatprice (in ₹) should he sell it in order to make a profit of 15%?**

A 11,730

B 13,370

C 18,590

D 23,560

Answer: A

Downloaded from cracku.in

61. **Study the given pie-chart and answer the question that follows.**
The pie-chart represents the percentage distribution of candidates qualified in a bank examination from six different districts of a State in 2016. The total number of qualified candidates from the State is 68000.

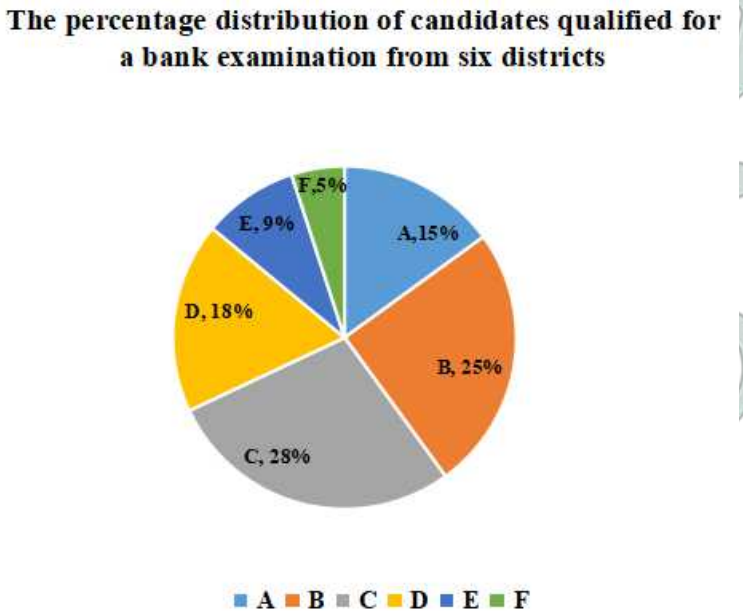

If 22% and 20% of the qualified students from Districts B and C. respectively. were 22 years old or below. then the number ofqualified students who were above 22 years from District B is what percent(to the nearestinteger) of the number of qualified students who were above 22 years from District C?

A 60

B 80

C 67

D 87

Answer: D

Downloaded from cracku.in

62. The given pie charts show the distribution of students of graduate and postgraduate levels in five different institutes. P,Q. R. S and T, in a town. Study the pie charts and answer the question that follows.
(i) Total number of students of graduate level in five different institutes = 12400

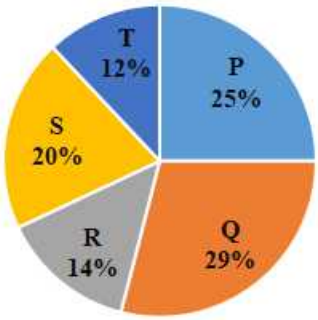

Fig. (i)

(ii) Total number of students of post graduate level in five different institutes = 8000

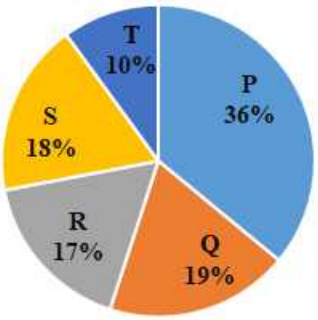

Fig. (ii)

The number of students in graduate level in institute S is approximately what percentage more than the number of students in post graduate level in institute S? (correct to one decimal place)

A 70.2%

B 72.2%

C 74.4%

D 62.2%

Answer: B

63. If $(3p-5m)=5$ and $pm=6$, then what is the value of $(9p^2-25m^2)$?

A $\pm 5\sqrt{385}$

B $30\sqrt{10}$

C $5\sqrt{385}$

D $\pm 30\sqrt{10}$

Answer: A

Daily Free SSC Practice Set

64. A number is mistakenly multiplied by $\frac{7}{5}$ instead of being multiplied by $\frac{3}{2}$. What is the percentage changein the result due to this mistake?

A $6\frac{2}{3}\%$

Downloaded from cracku.in

B $7\frac{2}{3}\%$

C $3\frac{2}{3}\%$

D $5\frac{2}{3}\%$

Answer: A

65. **When an integer n is divided by 6, the remainder is 5. What is the remainderif 9n is divided by 6?**

A 3

B 2

C 4

D 5

Answer: A

66. **If 9685 is divided into three parts in such a way that one-fourth ofthe first part, one-third of the second part and onesixth of the third part are equal, then what is the first part?**

A 4470

B 2253

C 2980

D 2235

Answer: C

Free SSC Study Material (18,000 Solved Questions)

67. **The sum of the radii of two circles is 286 cm and the area between the concentric circles is 50336 cm ^{2}. What are the radii (in cm) of the two circles? Take $\pi = \frac{22}{7}$**

A 115 and 91

B 115 and 171

C 91 and 84

D 171 and 84

Answer: B

68. **The average monthly expenditure of a man is ₹2,400 during the first three months, ₹3,500 during the next five months and ₹4,800 for the remaining four months.If his total saving is ₹3,500 during the entire year, then what is his average monthly income (in ₹)?**

A 4,550

B 4,100

C 3,700

D 3,950

Downloaded from cracku.in

Answer: D

69. **The diameter of a semi circle is 5.6 m. What is its perimeter (in m, correct to one decimal place)? (Take $\pi = \frac{22}{7}$)**

A 11.2

B 8.8

C 14.4

D 17.6

Answer: C

1500+ Very Important Free SSC Solved Questions

70. **What is the value of:**
$\frac{\left[\frac{1}{9} \div \frac{1}{9} of \frac{1}{9}\right] \times \frac{1}{9}}{\frac{1}{9} + \frac{1}{9} of \frac{1}{9}}$ **?**

A $9\frac{1}{81}$

B $8\frac{1}{10}$

C $9\frac{1}{10}$

D $8\frac{1}{81}$

Answer: B

71. **If $\tan\theta = 15$, then what is the value of $\sec\theta$?**

A $\sqrt{226}$

B $\frac{1}{\sqrt{224}}$

C $\frac{1}{\sqrt{226}}$

D $\sqrt{224}$

Answer: A

72. **A can complete a piece of work in 7 days and B can complete the same work in 12 days. A and B worked together for 3 days. C alone completed the remaining work in 9 days. How many days will C take to complete the same work entirely?**

A 21

B 28

C 14

D 35

Answer: B

Downloaded from cracku.in

SSC Exam Update Videos & Free Study Material (YouTube Channel)

73. **The sides AB and AC of a $\triangle ABC$ are produced up to points D and E. The bisectors of the exterior angles so formed, intersect each other at point I. If $\angle ACB$ is 66° and $\angle ABC = 44^\circ$, then what is the measure (in degrees) of $\angle BIC$?**

A 52

B 50

C 48

D 55

Answer: D

74. **If $x + y = 5$ and $x^2 + y^2 = 17$ then the value of $(x - y)^2$ is equal to:**

A 9

B 4

C 25

D 16

Answer: A

75. **Solve for x:**
$\sin^2 x - 4\sin x + 3 = 0, 0 \leq x \leq \frac{\pi}{2}$

A $\frac{\pi}{2}$

B $\frac{\pi}{4}$

C $\frac{\pi}{6}$

D $\frac{\pi}{3}$

Answer: A

Latest Job Updates on Telegram - Join here

General Awareness

76. **Teeyan is a festival celebrated in Punjab, which celebrates the on set of _____.**

A winter

B monsoon

C summer

D spring

Answer: B

Downloaded from cracku.in

Join SSC Daily Quiz Telegram Group

77. **Which of the following state got second rank in NITI ayog's export preparedness index 2020?**

A Kerala

B Maharashtra

C Tamil Nadu

D Gujarat

Answer: B

78. **Identify the name of the river which is inside the Dihang river**

A Sindhu

B Ganga

C Godavari

D Bhramaputra

Answer: D

79. **navapara wildlife sanctuary is located in which of the following Indian states?**

A Sikkim

B Kranataka

C Assam

D Chhattisgarh

Answer: D

80. **A tradinational musicial instrument 'pena' is related to which of the following states?**

A Sikkim

B Kerala

C Goa

D Manipur

Answer: D

81. **Which of the following is an example of gravitational potential energy?**

A Moving car

B Bullet fired from a gun

C Water that is behind a dam

Downloaded from cracku.in

D Foot kicking a ball

Answer: C

82. **In which Olympic Games did Karnam Malleswari become India's first woman to win an Olympic medal?**

A Atlanta 1996 Olympic Games

B Brazil 2016 Olympic Games

C London 2012 Olympic Games

D Sydney 2000 Olympic Games

Answer: D

SSC CHSL Free Mock Test

83. **Who among the following was the first para-athlete to receive the Rajiv Gandhi Khel Ratna?**

A Mariyappan Thangavelu

B Devendra Jhajharia

C Varun Singh Bhati

D Naresh Kumar Sharma

Answer: B

84. **Who among the following became the youngest Member of Parliament in the 17th Lok Sabha?**

A Nusrat Jahan Ruhi

B Chandrani Murmu

C Gaurav Gogoi

D Tejasvi Surya

Answer: B

85. **Who among the following is the author of the book 'A Fine Balance'?**

A Amitav Ghosh

B Shashi Tharoor

C Rohinton Mistry

D Arvind Adiga

Answer: C

SSC CHSL Prevoius Papers (DOWNLOAD PDF)

86. **Which of the following does NOT have an opportunity cost?**

Downloaded from cracku.in

A Soap

B Software

C Sunlight

D Stylus

Answer: C

87. **Which of the following rivers originates from the 'Rakas Lake'?**

A Chenab

B Beas

C Sutlej

D Jhelum

Answer: C

88. **Which of the following ministries had the highest percentage increase in budgetary allocation for Budget 2020-21?**

A Ministry of Home Affairs

B Ministry of Housing and Urban Affairs

C Ministry of Agriculture and Farmers' Welfare

D Ministry of Communications

Answer: D

SSC CGL Previous Papers (DOWNLOAD PDF)

89. **_____ was the first Test cricket captain of an independent Indian team.**

A Vijay Hazare

B Hemu Adhikari

C Bishan Singh Bedi

D Lala Amarnath

Answer: D

90. **Which of the following teams won the IPL 2020 trophy?**

A Chennai Super Kings

B Rajasthan Royals

C Mumbai Indians

D Delhi Capitals

Answer: C

Downloaded from cracku.in

91. **In which part of the human body will you find the 'superior rectus'?**

A Ear

B Eye

C Nose

D Tongue

Answer: B

SSC CGL Free Mock Test (Latest Pattern)

92. **Which of the following dynasties made Kanauj (Kanyakubja) its capital city?**

A Pala dynasty

B Pratihara dynasty

C Sena dynasty

D Chola dynasty

Answer: B

93. **In which year was Microsoft's Windows operating system first introduced?**

A 1985

B 1989

C 1991

D 1993

Answer: A

94. **Who among the following is the author of the book 'Cross Connection: The Big Circus Adventure'?**

A Aditya Chopra

B Rajkumar Rao

C Harman Baweja

D Jugal Hansraj

Answer: D

SSC CHSL Important Questions and Answers (Download PDF)

95. **Which of the following is India's fastest super computer as of December 2020?**

A PARAM Siddhi-AI

B SAGA-220

Downloaded from cracku.in

C Pratyush (Cray XC40)

D Mihir (Cray XC40)

Answer: A

96. **Which chemical reaction takes place during the cooking of meat?**

A The Finkelstein reaction

B The Swartz reaction

C The Gattermann reaction

D The Maillard reaction

Answer: D

97. **Which of the following is the highest hill station in India?**

A Leh

B Jogimatti

C Manali

D Ponmudi

Answer: A

SSC CHSL Study Material

98. **Which movie has been selected as India's official entry to the Oscars 2021?**

A Jallikattu

B Ek Hazarachi Note

C Yellow

D Fandry

Answer: A

99. **Identify the revolutionary from West Bengal who participated in the freedom movement.**

A Khudiram Bose

B Balakrishnan Nair

C Puli Thevar

D Mukunda Kakati

Answer: A

100. **_____ is a draft of a legislative proposal before the House.**

A A bill

Downloaded from cracku.in

B A revocation

C A provision

D An act

Answer: A

SSC CHSL Free App

SSC CHSL Free Mock Test

SSC CHSL Prevoius Papers (DOWNLOAD PDF)

SSC CGL Previous Papers (DOWNLOAD PDF)

SSC CGL Free Mock Test (Latest Pattern)

SSC CHSL Important Questions and Answers (Download PDF)

SSC CHSL Study Material

SSC CHSL Free App

Daily Free SSC Practice Set

Free SSC Study Material (18,000 Solved Questions)

1500+ Very Important Free SSC Solved Questions

SSC Exam Update Videos & Free Study Material (YouTube Channel)

Latest Job Updates on Telegram - Join here

Join SSC Daily Quiz Telegram Group

Downloaded from cracku.in